UNIVERSITY OF CAMBRIDGE INTERNATIONAL EXAMINATIONS
General Certificate of Education Advanced Subsidiary Level and Advanced Level

GEOGRAPHY **9696/21**

Paper 2 Advanced Physical Options **May/June 2013**

INSERT

1 hour 30 minutes

READ THESE INSTRUCTIONS FIRST

This Insert contains all the Figures and the Photographs referred to in the questions.

This document consists of **5** printed pages and **3** blank pages.

DC (LEG/CGW) 64010/2
© UCLES 2013

UNIVERSITY of CAMBRIDGE International Examinations

www.theallpapers.com

Photographs A and B for Question 2

Areas of tropical rainforest and savanna vegetation

A Tropical rainforest vegetation

B Savanna vegetation

© UCLES 2013

www.theallpapers.com

Fig. 1 for Question 4

Cartoon showing some threats to coral reefs

www.theallpapers.com

Fig. 2 for Question 6

Percentage deaths from different impacts of tropical storms in Bangladesh

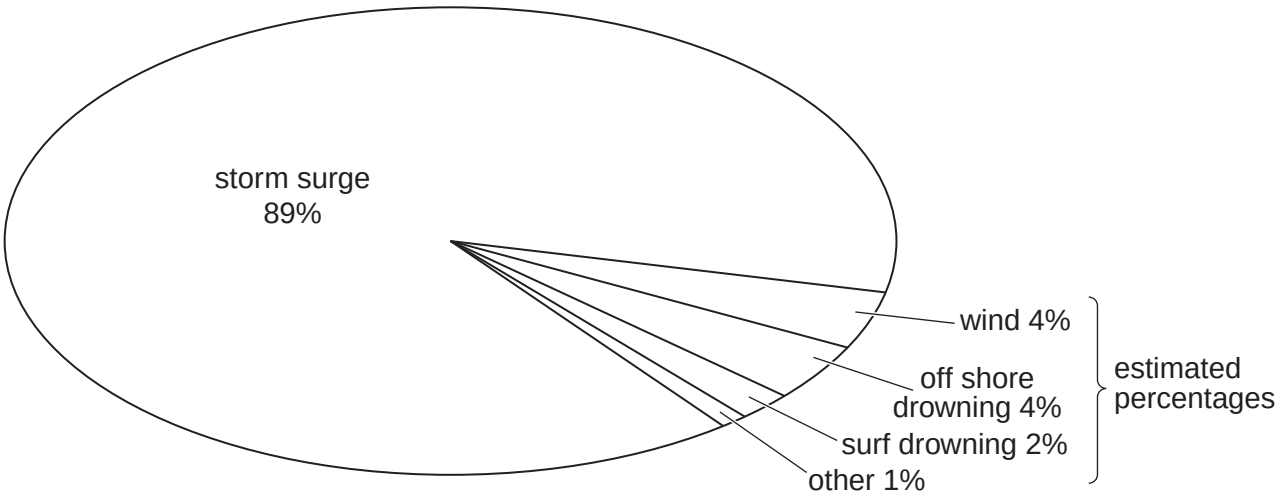

Fig. 3 for Question 6

Map to show the location of Bangladesh

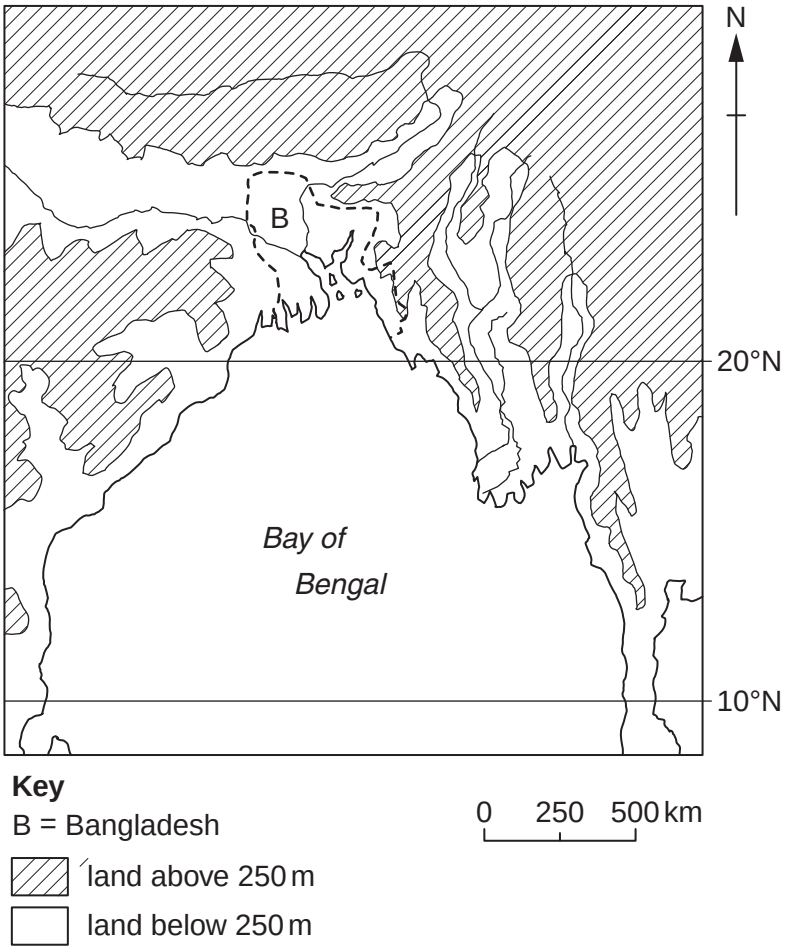

www.theallpapers.com

Fig. 4 for Question 8

Climate graphs for a hot arid environment and a semi-arid environment

A Hot arid (Latitude 25° N)

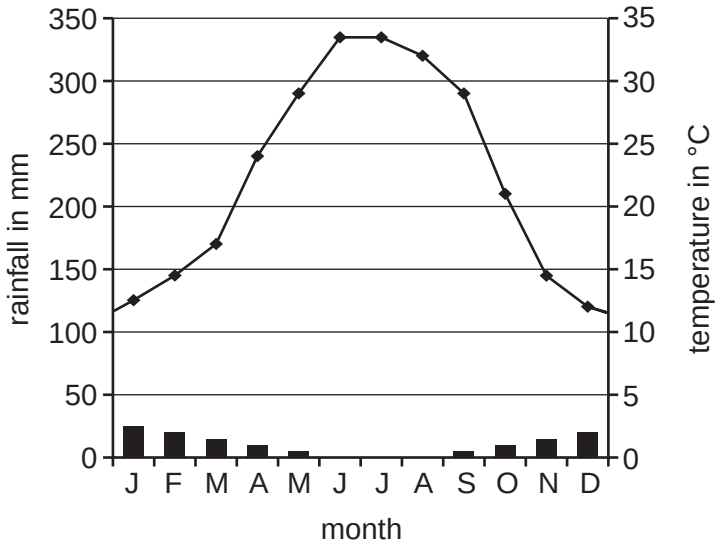

rainfall total: 102 mm

B Semi-arid (Latitude 15° N)

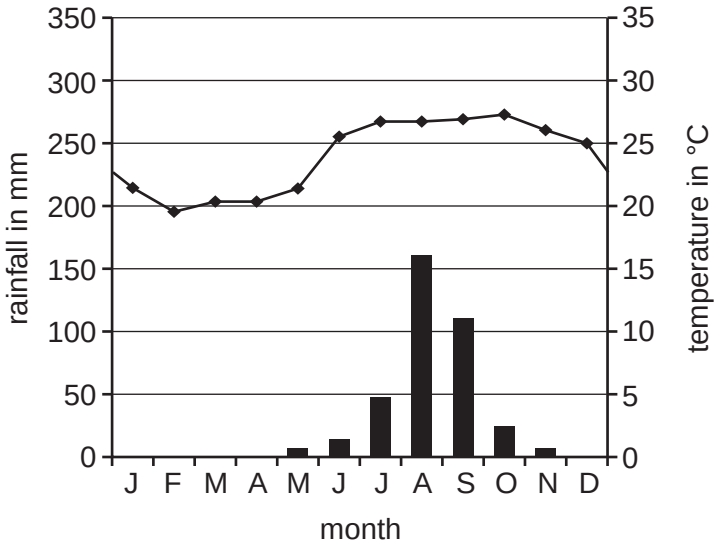

rainfall total: 380 mm

www.theallpapers.com

BLANK PAGE

www.theallpapers.com

BLANK PAGE

www.theallpapers.com

BLANK PAGE

Permission to reproduce items where third-party owned material protected by copyright is included has been sought and cleared where possible. Every reasonable effort has been made by the publisher (UCLES) to trace copyright holders, but if any items requiring clearance have unwittingly been included, the publisher will be pleased to make amends at the earliest possible opportunity.

University of Cambridge International Examinations is part of the Cambridge Assessment Group. Cambridge Assessment is the brand name of University of Cambridge Local Examinations Syndicate (UCLES), which is itself a department of the University of Cambridge.

© UCLES 2013

www.theallpapers.com